Name _____

National Physical Fitness Month
Elapsed time: problem solving

What a Workout!

Read each problem.
Write the time.
Draw hands on the clock to match.

A. Bonnie begins jogging at 3:10. It takes 35 minutes for her to jog to the gym. What time does she get there?  _____ : _____	B. Jim gets in line for the treadmill at 3:30. He doesn't get to the front of the line for 45 minutes. What time does Jim get on the treadmill?  _____ : _____	C. Mike is supposed to meet Karen at the 4:15 aerobics class. If Mike is one hour late, what time does he arrive at class?  _____ : _____
D. At 3:30 Carol starts swimming laps. If she swims for one hour and 10 minutes, what time does she stop?  _____ : _____	E. Ed rides a bicycle for 45 minutes. If he begins riding at 4:45, what time does he stop?  _____ : _____	F. Kim has 30 minutes to lift weights before her exercise class. If she starts at 4:50, what time does she need to stop?  _____ : _____
G. It is 5:10 when Brent takes an orange juice break. He leaves the juice bar 25 minutes later. What time is his break over? _____ : _____	H. Angie plans to meet Roy after she walks for 45 minutes. If she begins walking at 6:30, what time does she meet Roy?  _____ : _____	I. Larry has to be on the racquetball court in one hour and 35 minutes. If it is 6:40 now, what time does he need to be on the court?  _____ : _____

©The Education Center, Inc. • Teacher's Helper™ • TEC47888 • April/May 2001