Name:_____

CCSS 3.OA.3 Use multiplication and division within 100 to solve …..

Multiplication Arrays

Directions: Circle the problem shown by the array.



4 x 5 = 20
6 x 3 = 18
4 x 6 = 24



5 x 7 = 50
7 x 7 = 49
5 x 7= 35



6 x 3 = 18
6 x 5 = 30
4 x 6 = 24



4 x 5 = 20
5 x 5 = 25
5 x 5 = 20



8 x 2 = 16
9 x 2 = 20
9 x 2 = 18



4 x 7 = 28
8 x 4 = 30
4 x 8 = 32

© www.2ndgradeworksheets.net