3.0A.3

Name Taylor Date 1-13-14 Level 2 # 1

Bailey made 5 bracelets. Each bracelet has 12 beads.
How many beads did Baily use?

Groups of

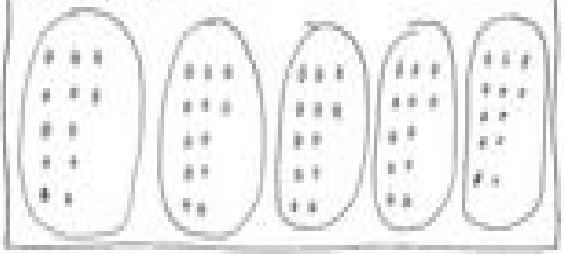

An Array



Jumps on a number line

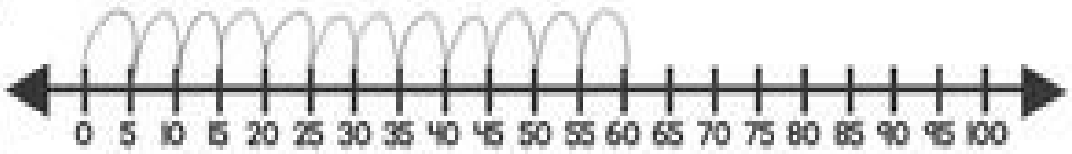

Equation

$5 \times 12 = 60$

The answer in a complete sentence.

Baily used 60 beads.