Name : _____ Score : _____

Teacher : _____ Date : _____

Parallel, Perpendicular, and Intersecting Lines

State wheither the given pair of lines are parallel, perpendicular, or intersecting.

1)



Answer: _____

2)

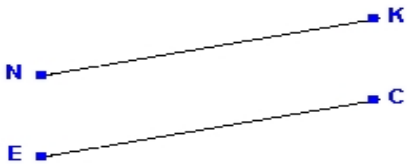

Answer: _____

3)

Answer: _____

4)

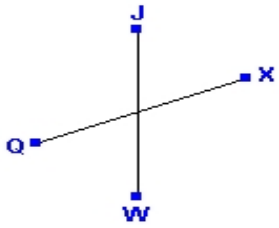

Answer: _____

5)

Answer: _____

6)

Answer: _____

Math-Aids.Com