Name : _____ Score : _____

Teacher : _____ Date : _____

Identify and Calculate the Area and Perimeter for each Polygon.

1)

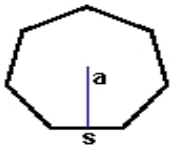

s = 3.4 ft

a = 1.7 ft

Area: _____

Perimeter: _____

Type: _____

2)

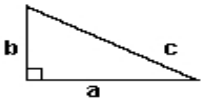

a = 8.2 yds b = 4.6 yds

c = 9.4 yds

Area: _____

Perimeter: _____

Type: _____

3)

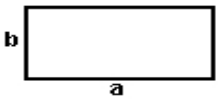

a = 8.9 ft b = 4.4 ft

Area: _____

Perimeter: _____

Type: _____

4)

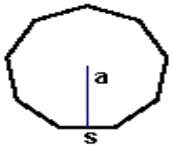

s = 3.3 yds

a = 1.65 yds

Area: _____

Perimeter: _____

Type: _____

5)

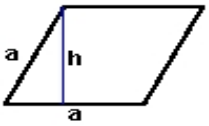

a = 6.6 cm h = 5.98 cm

Area: _____

Perimeter: _____

Type: _____

6)

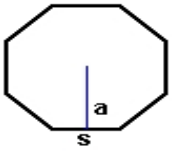

s = 7.6 mm

a = 3.29 mm

Area: _____

Perimeter: _____

Type: _____

7)

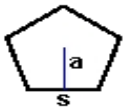

s = 5.4 mm

a = 2.57 mm

Area: _____

Perimeter: _____

Type: _____

8)

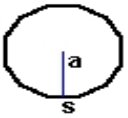

s = 2.5 cm

a = 1.25 cm

Area: _____

Perimeter: _____

Type: _____

9)

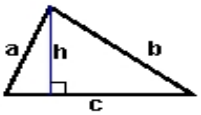

a = 5.8 inches b = 8.68 inches

c = 8.9 inches h = 5.4 inches

Area: _____

Perimeter: _____

Type: _____

Math-Aids.Com