Name_____

CCSS 2.MD.7 Tell and write time from analog and digital clocks to the nearest....

Telling Time

Directions: Draw in the minute and hour hands to match the digital time.

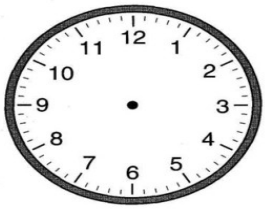

8:15

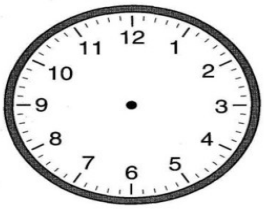

6 : 45

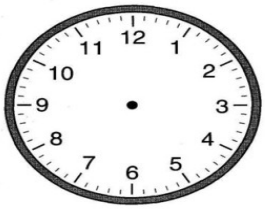

1 : 45

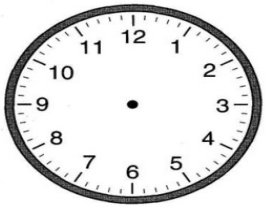

5 : 15

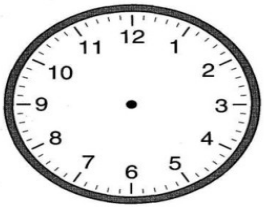

12:45

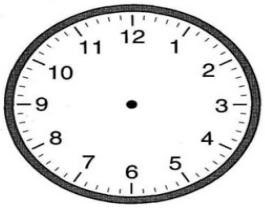

4:15

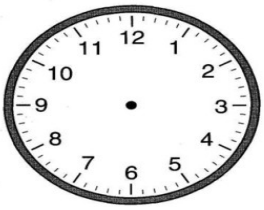

9:45

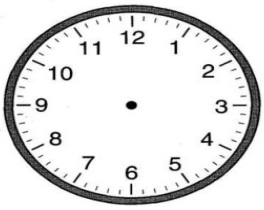

10:15

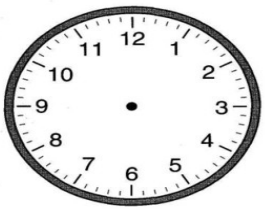

2:15

© Downloaded freely from www.theteachersguide.com