Identifying angles

State which of the angles in the drawings are:

- right angles
- acute angles
- obtuse angles
- reflex angles

a.

b.

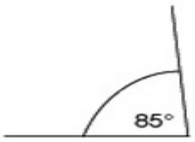

c.

d.

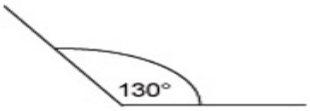

e.

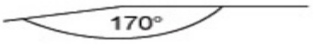

f.

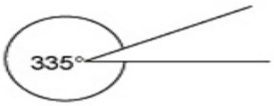

g.

h.

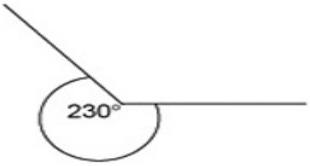

i.

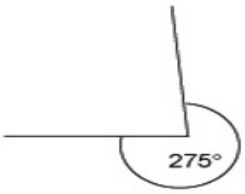

Now check your answers with the answer sheet.

© BBC 2011 BBC