Maths – Year 2 – Unit 2 – Day 9
Send-in task

Balancing Addition Equations

Write the missing number to make the scales balance. Then write a matching number sentence.

1.

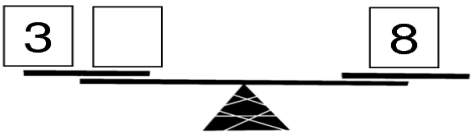

_____ + _____ = _____

2.

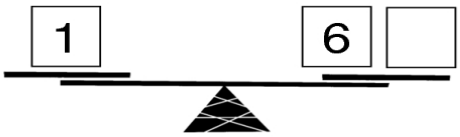

_____ + _____ = _____

3.

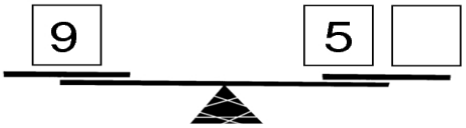

_____ + _____ = _____

4.

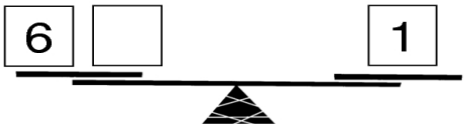

_____ + _____ = _____

Write the missing numbers to make these true

5.

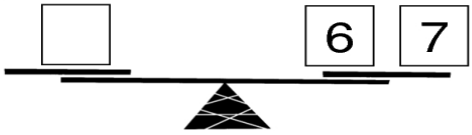

6.

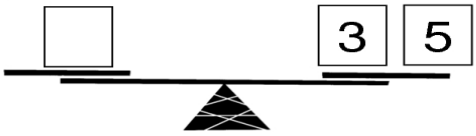

7.

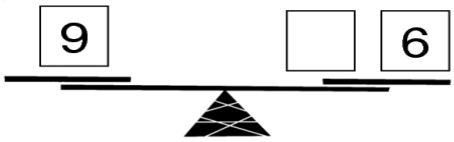
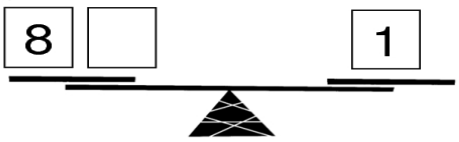
8.