Name_____

CCSS 2.MD.7 Tell and write time from analog and digital clocks to the nearest….

What time is it?

Directions: Write in the digital time.

:



:

:

:



:



:



:

:



:

© Downloaded freely from www.theteachersguide.com