Name : _____ **Score :** _____

Teacher : _____ **Date :** _____

Find the missing angle measurement in each set of supplementary angles.

1)

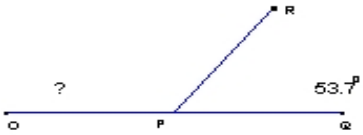

Angle = _____

2)

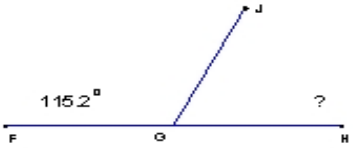

Angle = _____

3)

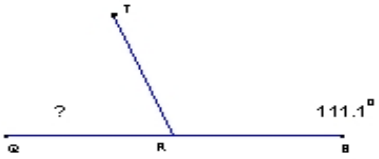

Angle = _____

4)

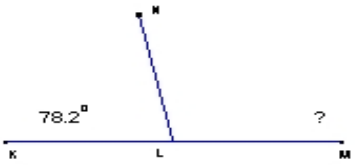

Angle = _____

5)

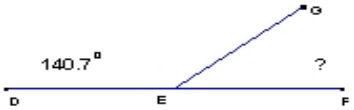

Angle = _____

6)

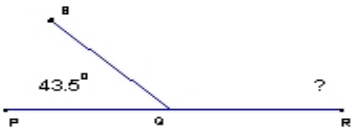

Angle = _____

7)

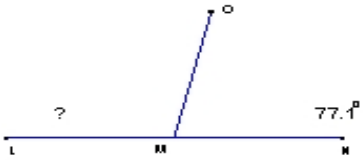

Angle = _____

8)

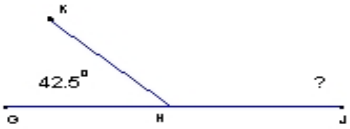

Angle = _____

Math-Aids.Com