Name:_____

CCSS Use addition to find the total number of objects arranged in rectangular arrays with up to 5 rows and up to 5 columns....

Repeated Addition Arrays

Directions: Write an equation to solve the problems.

Bob the Baker needs help counting the cookies on each cookie sheet. Use repeated addition to write an equation to show how many cookies are on each cookie sheet. Circle columns of cookies.

Example:

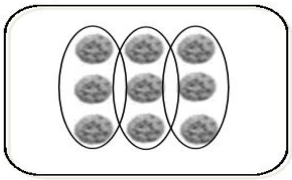

3 + 3 + 3= 9

1.



_____

2.



_____

3.



_____

4.



_____

____ I double checked my work.

© www.2ndgradeworksheets.net