Name : _____ Score : _____

Teacher : _____ Date : _____

Decimal Numbers on Number Lines

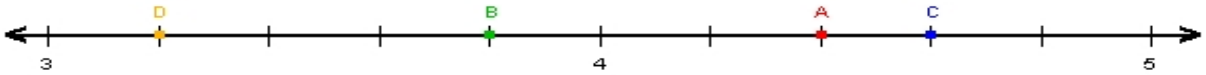

A = _____ B = _____ C = _____ D = _____

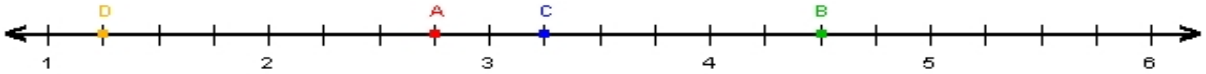

A = _____ B = _____ C = _____ D = _____

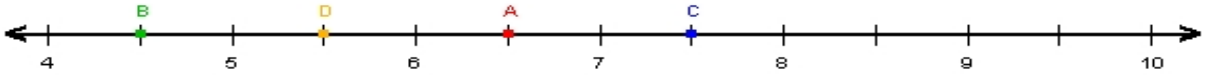

A = _____ B = _____ C = _____ D = _____

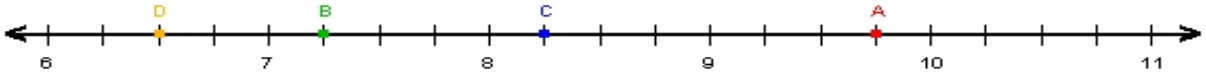

A = _____ B = _____ C = _____ D = _____

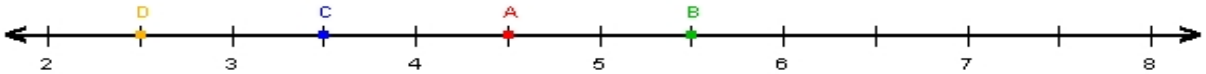

A = _____ B = _____ C = _____ D = _____

Math-Aids.Com