Math Word Problems Worksheet 6

Matt likes playing marbles. At the beginning of the week, he had a bag with 34 marbles in it. On Monday, he won 28 marbles. On Tuesday, he lost 11 marbles. On Wednesday, he visited his cousin who gave him 58 marbles. On Thursday, he won 3 marbles. On Friday, he lost 12 marbles. On Saturday, he bought 26 marbles.
How many marbles did Matt have in his bag on Sunday?



Alice bought a 24 metre roll of shiny blue ribbon.

She used 2 metres to wear in her hair.
She gave two metres to her father to use on a gift.
She used half a metre to tie around her cat's neck.
She gave her best friend Betty 3 metres.
She used half a metre to decorate her pencil.

How much does Alice have left?

Black Pirate Steve raided a village and stole the following:
5 bags, each filled with 50 pieces of gold,
a chest filled with 250 pieces of gold,
a bracelet threaded with 8 pieces of gold,
a piggy bank filled with 64 pieces of gold,
an old tin filled with 120 pieces of gold and
a large leather purse filled with 48 pieces of gold.

How many pieces of gold did he get altogether?
If he shares half of this with his 6 crew members,
How much do they each get?



This bird eats 24 pieces of bird seed every morning and 26 pieces every night.

How many does she eat in a day?

How many does she eat in a week?

How many does she eat in 4 weeks?

How many does she eat in 52 weeks

Patrick has been working hard all day painting a house.

It took him 2 hours and 15 minutes to paint the lounge room, 1 hour and 20 minutes to paint the bathroom, 2 hours to paint the hallway, 1 hour and 10 minutes to paint each of the three bedrooms and 2 hours and 35 minutes to paint the kitchen.

How long has he been painting? If he started at 7:00 a.m. and had a half hour break, when did he finish?