**Student Name:** _____ **Score:**

## Is it Right Angled Triangle?

Check whether the given triangles are right angled triangle using Pythagorean rule: Work Space

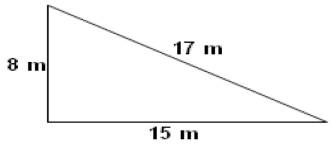


Answer:

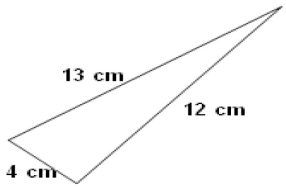


Answer:

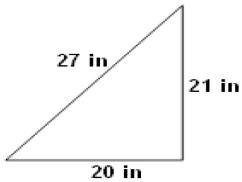


Answer:

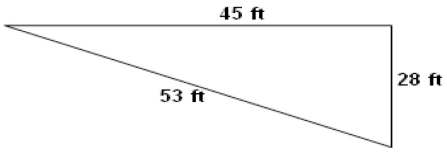


Answer: