Student Name: _____ **Score:**

Solve and Graph

Work Space

1) $x - 3 < -2$

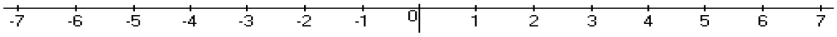

2) $\frac{x}{5} \geq -1$

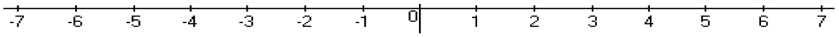

3) $2 \leq x - 4$

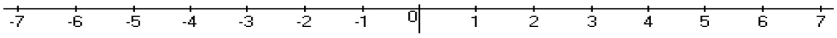
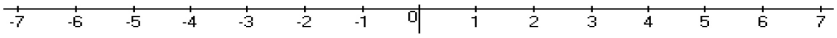
4) $-7x > -28$