Name _____

Valentine Base Ten Blocks



Directions: Count how many base ten blocks are in each group and record your answers. Cut and paste the correct heart to match the answer.



____ tens ____ ones

____ in all

____ tens ____ ones

____ in all



____ tens ____ ones

____ in all



____ tens ____ ones

____ in all



____ tens ____ ones

____ in all



____ tens ____ ones

____ in all

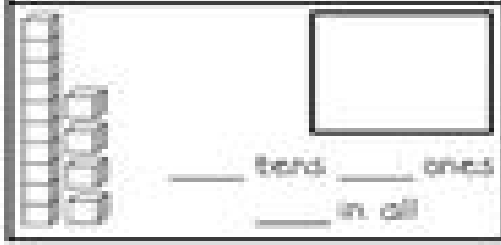

____ tens ____ ones

____ in all



____ tens ____ ones

____ in all