Name _____

Class _____

# Note Names – Treble and Bass Clef

**DIRECTIONS:** Draw an **X** over any note that is not an F.

1. 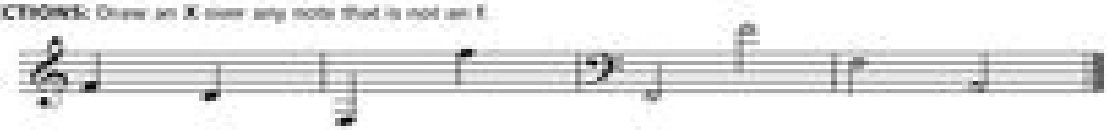

**DIRECTIONS:** Directions: Draw an **X** over any note that is not an A.

2. 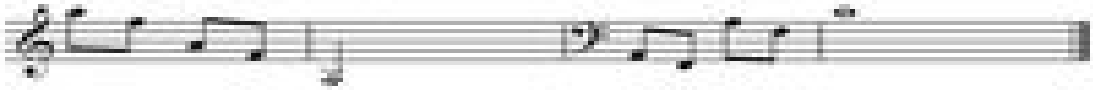

**DIRECTIONS:** Directions: Draw an **X** over any note that is not an E.

3. 

**DIRECTIONS:** Directions: Draw an **X** over any note that is not a D.

4. 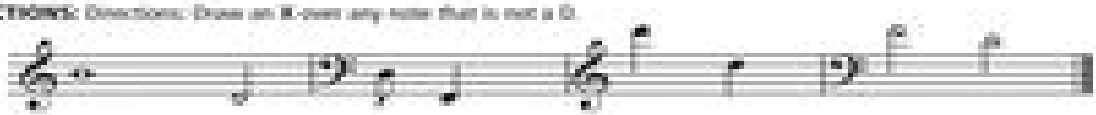

**DIRECTIONS:** In the following examples, draw an **X** over the measure that does not have two notes with the same letter name.

5. 

6.

**DIRECTIONS:** True or false? Are the notes the same? Circle T or F.

7. 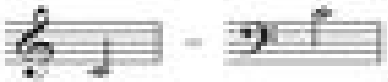 T F

8. T F

9. 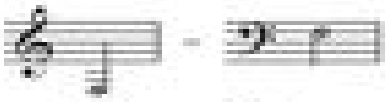 T F

10. T F

Copyright © 2007 by Alfred Publishing Co., Inc.
Note: the purchase of this book carries with it the right to photocopy the page
(unless so one school only. NOT FOR RESALE.