Score	
	12

06-01-03-011-s

Name:_____ Subject: Year 6 Numeracy

Date:_____ Unit: Rotation

Look at the shapes below. Rotate each shape 1st 90° then 180° in a clockwise direction.

1)

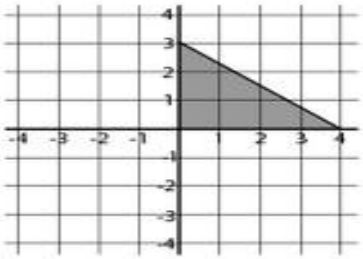

2)

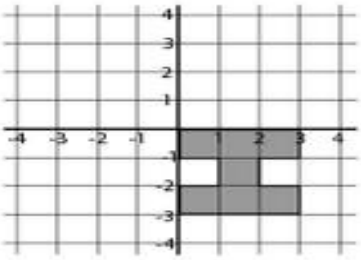

3)

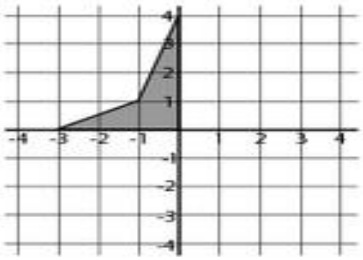

4)

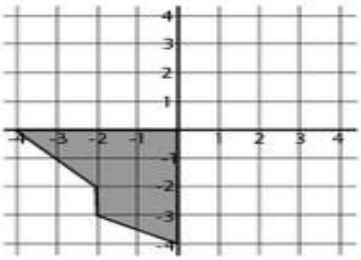

5)

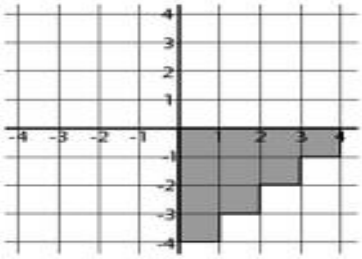

6)

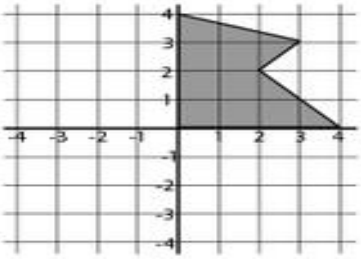

© Primary Leap Ltd. 2008