NAME _____

3-D Shapes

Cone

Faces: _____

Edges: _____

Vertices: _____



Cylinder

Faces: _____

Edges: _____

Vertices: _____

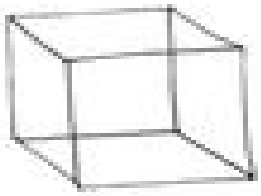

Cube

Faces: _____

Edges: _____

Vertices: _____

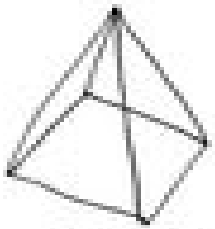

Pyramid

Faces: _____

Edges: _____

Vertices: _____



Rectangular Prism

Faces: _____

Edges: _____

Vertices: _____

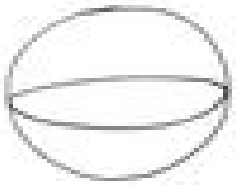

Sphere

Faces: _____

Edges: _____

Vertices: _____

© Lorraine Prince