Name : _____ Score : _____

Teacher : _____ Date : _____

Triangle Medians

Each triangle shows all three of its medians drawn.

1) Find YN if UN = 10.

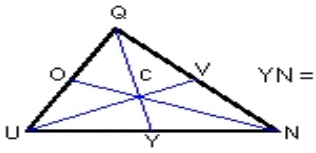

YN = _____

2) Find JQ if KQ = 16.

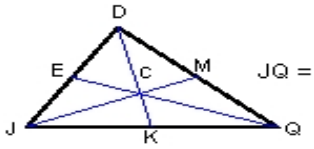

JQ = _____

3) SP = 18. Find CS.

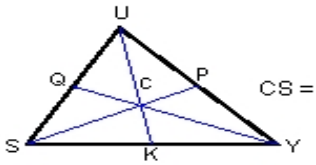

CS = _____

4) CH = 17. Find JH.

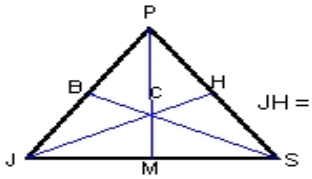

JH = _____

5) BY = 51. Find CY.

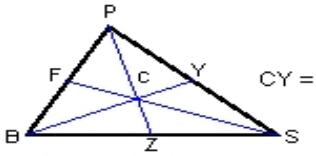

CY = _____

6) Find OZ if RZ = 14.

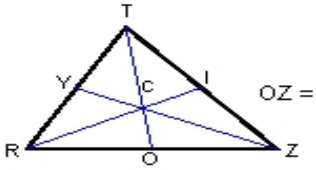

OZ = _____

7) Find JA if TA = 12.

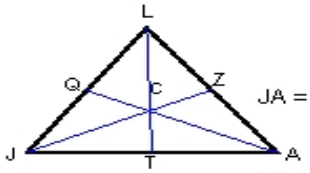

JA = _____

8) HA = 12. Find CH.

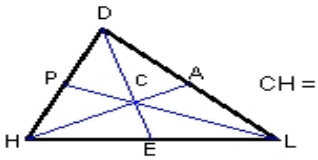

CH = _____

Math-Aids.Com