Name : _____ Score : _____

Teacher : _____ Date : _____

Identify and Calculate the Area and Perimeter for each Qualrilateral.

1)

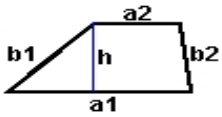

a1 = 8.7 ft a2 = 4.1 ft
b1 = 5.86 ft b2 = 4.23 ft
h = 4.2 ft

Area: _____
Perimeter: _____
Type: _____

2)

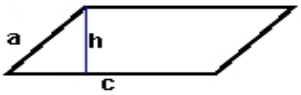

a = 4.38 yds
c = 9.9 yds h = 4.1 yds

Area: _____
Perimeter: _____
Type: _____

3)

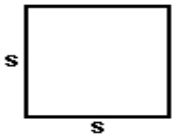

s = 6.8 mm

Area: _____
Perimeter: _____
Type: _____

4)

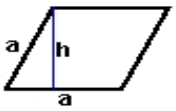

a = 5.5 inches h = 5.02 inches

Area: _____
Perimeter: _____
Type: _____

5)

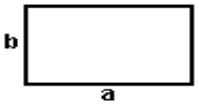

a = 7.9 inches b = 4.8 inches

Area: _____
Perimeter: _____
Type: _____

6)

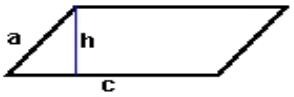

a = 4.42 ft
c = 10 ft h = 4.2 ft

Area: _____
Perimeter: _____
Type: _____

7)

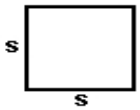

s = 5.1 yds

Area: _____
Perimeter: _____
Type: _____

8)

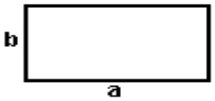

a = 8.7 cm b = 4.6 cm

Area: _____
Perimeter: _____
Type: _____

9)

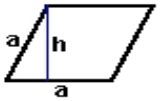

a = 5 mm h = 4.6 mm

Area: _____
Perimeter: _____
Type: _____

Math-Aids.Com