Area and Perimeter: finding parts of geometry figures

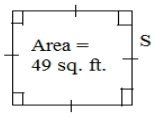


S = _____

Perimeter = _____

Rectangle

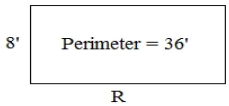


R = _____

Area = _____

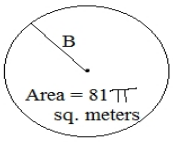


B = _____

Circumference = _____

Perimeter = 168 inches

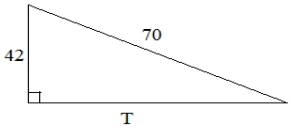


T = _____

Area = _____

Trapezoid

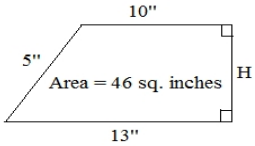


H = _____

Perimeter = _____

Area = 100 sq. units

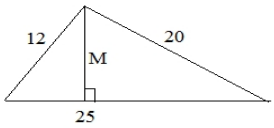


M = _____

Circumference = 12 feet

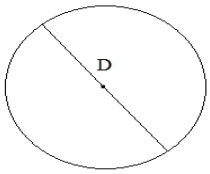


(diameter) D = _____

Area = _____

Area = 540 sq. meters

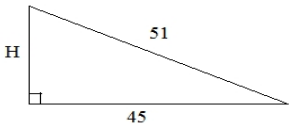


H = _____

Perimeter = _____

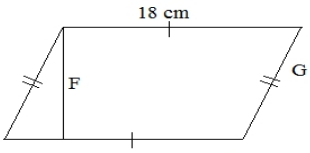


Area = 216 $cm^2$

Perimeter = 62 cm

F = _____

G = _____