Student Name: _____ **Score:**

Supplementary Angles

Find the missing angles in the following supplementary angles:

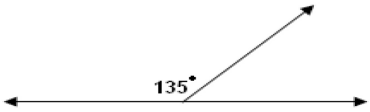

Answer: _____

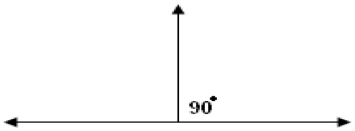

Answer: _____

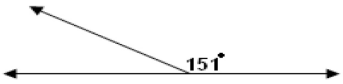

Answer: _____

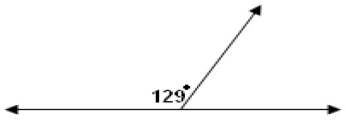

Answer: _____

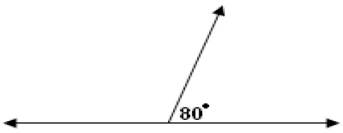

Answer: _____



Answer: _____