Score

	18

03-01-03-006-s

Name: _____ Subject: Year 3 Numeracy

Date: _____ Sheet: 2D shapes

2D shapes

Name each shape and count how many sides each shape has got.

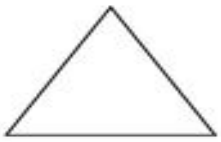

name _____

sides _____

name _____

sides _____

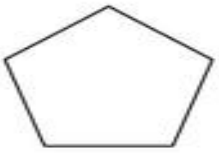

name _____

sides _____

name _____

sides _____

name _____

sides _____

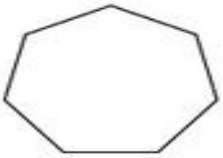

name _____

sides _____

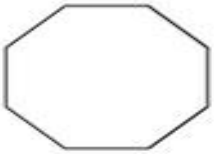

name _____

sides _____

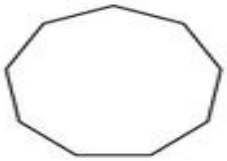

name _____

sides _____

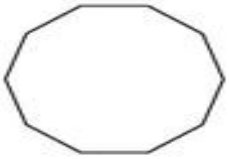

name _____

sides _____

© Primary Leap Ltd. 2012