Partner Paper

Names:_____

Measure each angle and classify it as right, acute, straight, or obtuse.

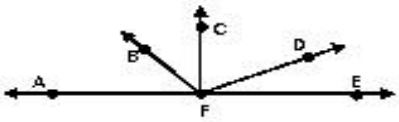 m∠AFB=_____	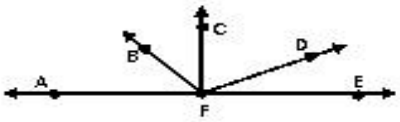 m∠DFE=_____
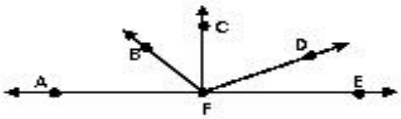 m∠AFD=_____	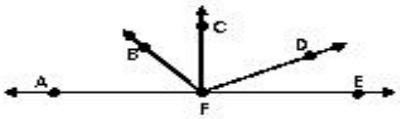 m∠BFE=_____
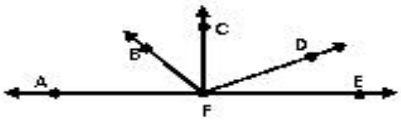 m∠CFB=_____	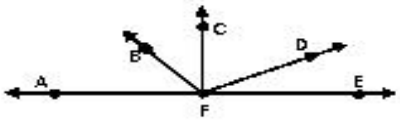 m∠AFE=_____
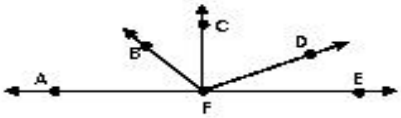 m∠BFD=_____	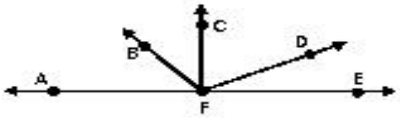 m∠CFE=_____