NAME:_____ DATE:_____

Find the volume and surface area of each figure. (Figures shown are not drawn to scale)

1)

2) 

3) 

4)

5)

6) 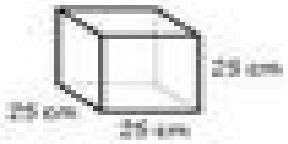

7) 

8) 

9) 
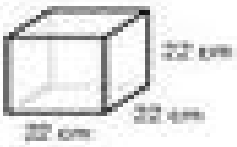
10)