Name:_____

CCSS 2.MD.1 Measure the length of an object ……primer

Measurement

Directions: How many ladybugs long is each object?

1. _____ ladybugs long



2. _____ ladybugs long



3. _____ ladybugs long

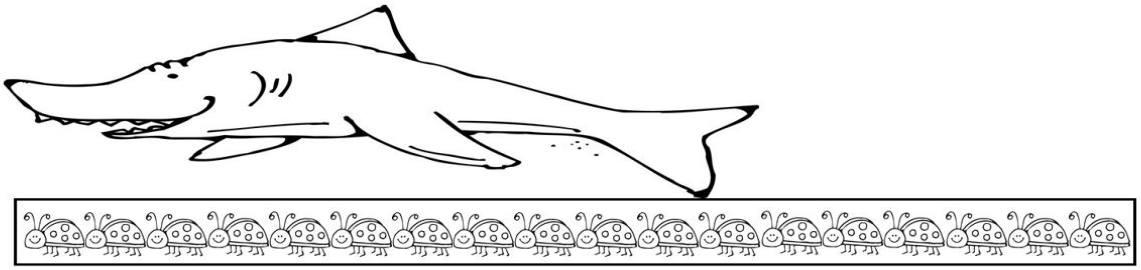

Graphics/fonts copyright DJ Inkers. www.djinkers.com